Ecris les fractions correspondant aux figures.



$\frac{\quad}{20}$

$\frac{\quad}{10}$

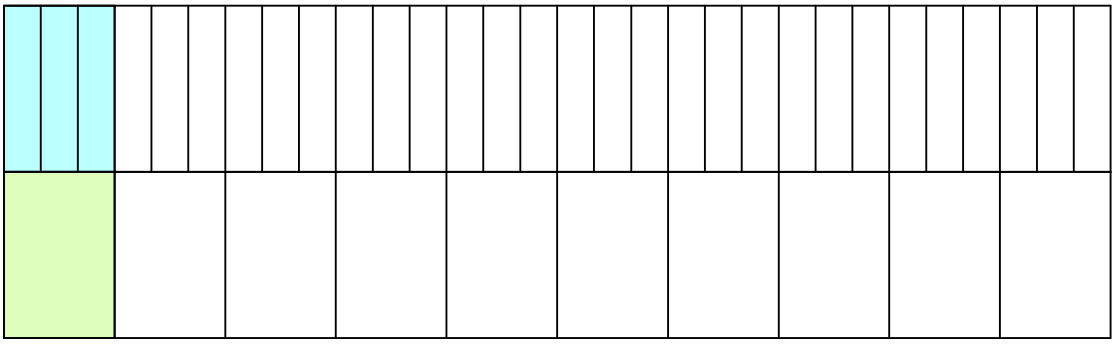

$\frac{\quad}{30}$

$\frac{\quad}{10}$



$\frac{\quad}{20}$

$\frac{\quad}{10}$



$\frac{\quad}{20}$

$\frac{\quad}{10}$



$\frac{\quad}{20}$

$\frac{\quad}{10}$